Cambridge Assessment International Education

Cambridge International AS & A Level

CANDIDATE NAME	

CENTRE NUMBER						CANDIDATE NUMBER				

5712505207

MATHEMATICS **9709/12**

Paper 1 Pure Mathematics 1 **February/March 2021**

1 hour 50 minutes

You must answer on the question paper.

You will need: List of formulae (MF19)

INSTRUCTIONS

- Answer **all** questions.
- Use a black or dark blue pen. You may use an HB pencil for any diagrams or graphs.
- Write your name, centre number and candidate number in the boxes at the top of the page.
- Write your answer to each question in the space provided.
- Do **not** use an erasable pen or correction fluid.
- Do **not** write on any bar codes.
- If additional space is needed, you should use the lined page at the end of this booklet; the question number or numbers must be clearly shown.
- You should use a calculator where appropriate.
- You must show all necessary working clearly; no marks will be given for unsupported answers from a calculator.
- Give non-exact numerical answers correct to 3 significant figures, or 1 decimal place for angles in degrees, unless a different level of accuracy is specified in the question.

INFORMATION

- The total mark for this paper is 75.
- The number of marks for each question or part question is shown in brackets [ ].

This document has **20** pages. Any blank pages are indicated.

© UCLES 2021

PMT

BLANK PAGE

1 **(a)** Find the first three terms in the expansion, in ascending powers of x, of $(1 + x)^5$. [1]

.....

.....

.....

.....

.....

.....

(b) Find the first three terms in the expansion, in ascending powers of x, of $(1 - 2x)^6$. [2]

.....

.....

.....

.....

.....

.....

(c) Hence find the coefficient of x^2 in the expansion of $(1 + x)^5(1 - 2x)^6$. [2]

.....

.....

.....

.....

.....

.....

.....

.....

.....

.....

2 By using a suitable substitution, solve the equation

$$(2x-3)^2 - \frac{4}{(2x-3)^2} - 3 = 0.$$ [4]

3 Solve the equation $\dfrac{\tan\theta + 2\sin\theta}{\tan\theta - 2\sin\theta} = 3$ for $0° < \theta < 180°$. [4]

4 A line has equation $y = 3x + k$ and a curve has equation $y = x^2 + kx + 6$, where k is a constant.

Find the set of values of k for which the line and curve have two distinct points of intersection. [5]

5

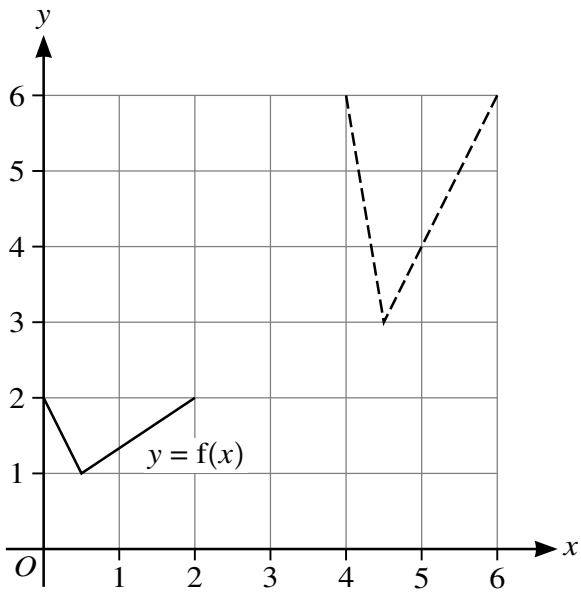

In the diagram, the graph of $y = \mathrm{f}(x)$ is shown with solid lines. The graph shown with broken lines is a transformation of $y = \mathrm{f}(x)$.

(a) Describe fully the two single transformations of $y = \mathrm{f}(x)$ that have been combined to give the resulting transformation. [4]

.....

.....

.....

.....

.....

.....

.....

.....

(b) State in terms of y, f and x, the equation of the graph shown with broken lines. [2]

.....

.....

.....

.....

.....

6 A curve is such that $\frac{dy}{dx} = \frac{6}{(3x-2)^3}$ and $A\,(1,\ -3)$ lies on the curve. A point is moving along the curve and at A the y-coordinate of the point is increasing at 3 units per second.

(a) Find the rate of increase at A of the x-coordinate of the point. [3]

(b) Find the equation of the curve. [4]

7 Functions f and g are defined as follows:

$$\mathrm{f} : x \mapsto x^2 + 2x + 3 \text{ for } x \leqslant -1,$$
$$\mathrm{g} : x \mapsto 2x + 1 \text{ for } x \geqslant -1.$$

(a) Express $\mathrm{f}(x)$ in the form $(x + a)^2 + b$ and state the range of f. [3]

(b) Find an expression for $f^{-1}(x)$. [2]

.....

.....

.....

.....

.....

.....

.....

.....

.....

.....

.....

.....

(c) Solve the equation $gf(x) = 13$. [3]

.....

.....

.....

.....

.....

.....

.....

.....

.....

.....

.....

.....

8 The points $A\,(7,\ 1)$, $B\,(7,\ 9)$ and $C\,(1,\ 9)$ are on the circumference of a circle.

(a) Find an equation of the circle. [5]

.....

.....

.....

.....

.....

.....

.....

(b) Find an equation of the tangent to the circle at B. [2]

.....

.....

.....

.....

.....

.....

.....

.....

.....

.....

.....

.....

.....

.....

.....

.....

.....

9 The first term of a progression is $\cos\theta$, where $0 < \theta < \frac{1}{2}\pi$.

(a) For the case where the progression is geometric, the sum to infinity is $\dfrac{1}{\cos\theta}$.

(i) Show that the second term is $\cos\theta\sin^2\theta$. [3]

.....

.....

.....

.....

.....

.....

.....

.....

.....

.....

(ii) Find the sum of the first 12 terms when $\theta = \frac{1}{3}\pi$, giving your answer correct to 4 significant figures. [2]

.....

.....

.....

.....

.....

.....

.....

.....

.....

.....

.....

(b) For the case where the progression is arithmetic, the first two terms are again $\cos\theta$ and $\cos\theta\sin^2\theta$ respectively.

Find the 85th term when $\theta = \frac{1}{3}\pi$. [4]

10

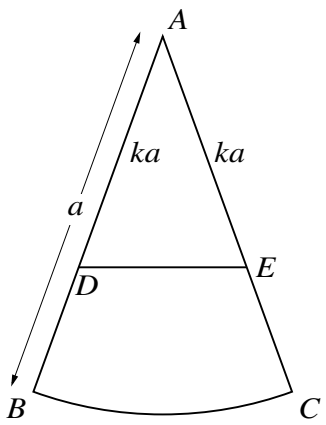

The diagram shows a sector ABC which is part of a circle of radius a. The points D and E lie on AB and AC respectively and are such that $AD = AE = ka$, where $k < 1$. The line DE divides the sector into two regions which are equal in area.

(a) For the case where angle $BAC = \frac{1}{6}\pi$ radians, find k correct to 4 significant figures. [5]

.....

.....

.....

.....

.....

.....

.....

.....

.....

.....

.....

.....

.....

.....

.....

.....

(b) For the general case in which angle $BAC = \theta$ radians, where $0 < \theta < \frac{1}{2}\pi$, it is given that $\dfrac{\theta}{\sin\theta} > 1$.

Find the set of possible values of k. [3]

.....

.....

.....

.....

.....

.....

.....

.....

.....

.....

.....

.....

.....

.....

.....

.....

.....

.....

.....

.....

.....

.....

.....

.....

11

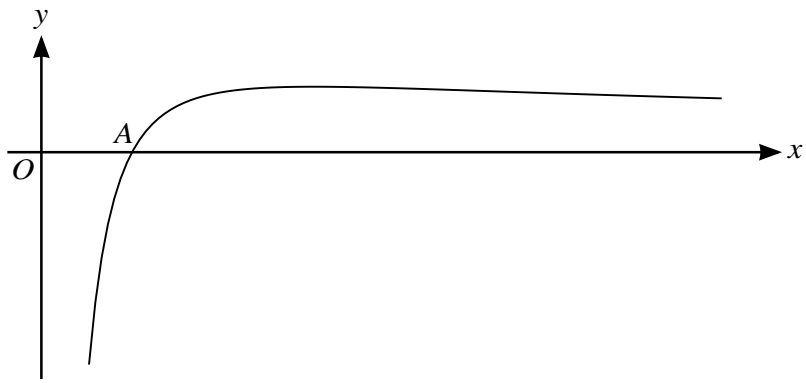

The diagram shows the curve with equation $y = 9\left(x^{-\frac{1}{2}} - 4x^{-\frac{3}{2}}\right)$. The curve crosses the x-axis at the point A.

(a) Find the x-coordinate of A. [2]

.....

.....

.....

.....

.....

.....

.....

(b) Find the equation of the tangent to the curve at A. [4]

.....

.....

.....

.....

.....

.....

.....

.....

.....

(c) Find the x-coordinate of the maximum point of the curve. [2]

.....

.....

.....

.....

.....

.....

(d) Find the area of the region bounded by the curve, the x-axis and the line $x = 9$. [4]

.....

.....

.....

.....

.....

.....

.....

.....

.....

.....

.....

.....

.....

.....

.....

.....

.....

.....

Additional Page

If you use the following lined page to complete the answer(s) to any question(s), the question number(s) must be clearly shown.

.....

.....

.....

.....

.....

.....

.....

.....

.....

.....

.....

.....

.....

.....

.....

.....

.....

.....

.....

.....

.....

Permission to reproduce items where third-party owned material protected by copyright is included has been sought and cleared where possible. Every reasonable effort has been made by the publisher (UCLES) to trace copyright holders, but if any items requiring clearance have unwittingly been included, the publisher will be pleased to make amends at the earliest possible opportunity.

To avoid the issue of disclosure of answer-related information to candidates, all copyright acknowledgements are reproduced online in the Cambridge Assessment International Education Copyright Acknowledgements Booklet. This is produced for each series of examinations and is freely available to download at www.cambridgeinternational.org after the live examination series.

Cambridge Assessment International Education is part of the Cambridge Assessment Group. Cambridge Assessment is the brand name of the University of Cambridge Local Examinations Syndicate (UCLES), which itself is a department of the University of Cambridge.

© UCLES 2021